1 Each bag has 6 apples.



Work out the number of apples in

3 bags: 6 × 3 = **18**

6 bags: 6 × 6 = **36**

9 bags: 6 × 9 = **54**

2 Complete the multiplications.

7 × 3 = **21**

7 × 6 = **42**

7 × 9 = **63**

Quiz ID: a7e5e9a7 - f162 - 493e - a891 - bfc4035788b4
White Rose Education grant WRE Infinity School a licence to use this content only, subject to our standard terms and conditions.

© White Rose Education Ltd. 2026

3 The cost of 3 lemonades is £4



What is the cost of 6 lemonades? £ **8**

What is the cost of 9 lemonades? £ **12**

4 How many cookies are there?



21

Quiz ID: a7e5e9a7 - f162 - 493e - a891 - bfc4035788b4

White Rose Education grant WRE Infinity School a licence to use this content only, subject to our standard terms and conditions.

© White Rose Education Ltd. 2026

5 Write two multiplication and two division facts shown by the array.



5	×	**7**	=	**35**
7	×	**5**	=	**35**
35	÷	**5**	=	**7**
35	÷	**7**	=	**5**

Accept any order.

6 Complete the calculations.

12 × 7 = **84**

2 × 7 = 14

7 × 5 = **35**

7 × **3** = 21

Quiz ID: a7e5e9a7 - f162 - 493e - a891 - bfc4035788b4
White Rose Education grant WRE Infinity School a licence to use this content only, subject to our standard terms and conditions.

© White Rose Education Ltd. 2026

7 Complete the calculations.

56 ÷ 7 = **8**

14 ÷ 7 = 2

21 ÷ 7 = **3**

63 ÷ 7 = 9

8 Use the cards to complete the sentences.
Each card can only be used once.

7 **9** **77** **21** **42**

1 week has **7** days.

3 weeks have **21** days.

9 weeks have 63 days.

9 Complete the calculations.

10 × 11 = **110**

7 × 11 = 77

11 × 8 = **88**

11 × **5** = 55

Quiz ID: a7e5e9a7 - f162 - 493e - a891 - bfc4035788b4
White Rose Education grant WRE Infinity School a licence to use this content only, subject to our standard terms and conditions.

© White Rose Education Ltd. 2026

10 Complete the calculations.

$99 \div 11 =$ **9**

66 $\div 11 = 6$

$132 \div 11 =$ **12**

44 $\div 11 = 4$

11 Complete the sentences.

A football team has 11 players.

7 teams have **77** players.

11 teams have 121 players.

12 Complete the calculations.

$24 \times 10 =$ **240**

$24 \times 11 =$ **264**

Quiz ID: a7e5e9a7 - f162 - 493e - a891 - bfc4035788b4
White Rose Education grant WRE Infinity School a licence to use this content only, subject to our standard terms and conditions.

© White Rose Education Ltd. 2026