Name: _____ Date: _____

1 Each bag has 6 apples.



Work out the number of apples in

3 bags: $6 \times 3 =$ ☐

6 bags: $6 \times 6 =$ ☐

9 bags: $6 \times 9 =$ ☐

2 Complete the multiplications.

$7 \times 3 =$ ☐

$7 \times 6 =$ ☐

$7 \times 9 =$ ☐

Quiz ID: a7e5e9a7 - f162 - 493e - a891 - bfc4035788b4
White Rose Education grant WRE Infinity School a licence to use this content only, subject to our standard terms and conditions.

© White Rose Education Ltd. 2026

3 The cost of 3 lemonades is £4



What is the cost of 6 lemonades? £

What is the cost of 9 lemonades? £

4 How many cookies are there?



Quiz ID: a7e5e9a7 - f162 - 493e - a891 - bfc4035788b4

White Rose Education grant WRE Infinity School a licence to use this content only, subject to our standard terms and conditions.

© White Rose Education Ltd. 2026

5 Write two multiplication and two division facts shown by the array.



$\square \times \square = \square$

$\square \times \square = \square$

$\square \div \square = \square$

$\square \div \square = \square$

6 Complete the calculations.

$12 \times 7 = \square$

$\square \times 7 = 14$

$7 \times 5 = \square$

$7 \times \square = 21$

Quiz ID: a7e5e9a7 - f162 - 493e - a891 - bfc4035788b4
White Rose Education grant WRE Infinity School a licence to use this content only, subject to our standard terms and conditions.

© White Rose Education Ltd. 2026

7 Complete the calculations.

$56 \div 7 =$ ☐

☐ $\div 7 = 2$

$21 \div 7 =$ ☐

☐ $\div 7 = 9$

8 Use the cards to complete the sentences.
Each card can only be used once.

7	**9**	**77**	**21**	**42**

1 week has ☐ days.

3 weeks have ☐ days.

☐ weeks have 63 days.

9 Complete the calculations.

$10 \times 11 =$ ☐

☐ $\times 11 = 77$

$11 \times 8 =$ ☐

$11 \times$ ☐ $= 55$

Quiz ID: a7e5e9a7 - f162 - 493e - a891 - bfc4035788b4
White Rose Education grant WRE Infinity School a licence to use this content only, subject to our standard terms and conditions.

© White Rose Education Ltd. 2026

10 Complete the calculations.

$99 \div 11 = \square$

$\square \div 11 = 6$

$132 \div 11 = \square$

$\square \div 11 = 4$

11 Complete the sentences.

A football team has 11 players.

7 teams have $\square$ players.

$\square$ teams have 121 players.

12 Complete the calculations.

$24 \times 10 = \square$

$24 \times 11 = \square$

Quiz ID: a7e5e9a7 - f162 - 493e - a891 - bfc4035788b4
White Rose Education grant WRE Infinity School a licence to use this content only, subject to our standard terms and conditions.

© White Rose Education Ltd. 2026