1 Use the cards to complete the number sentences.

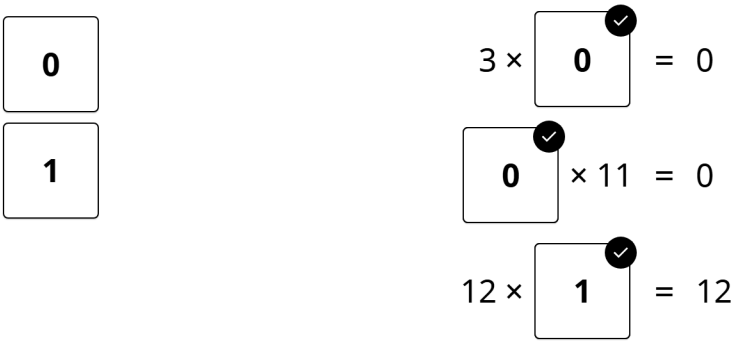

2 Use the cards to complete the number sentences.

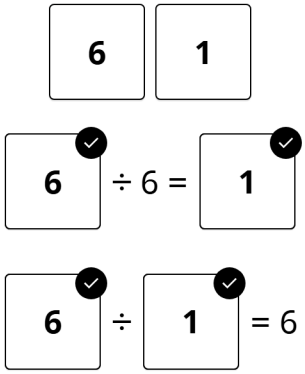

Quiz ID: 49d701dd - 6c4b - 4f42 - 9227 - 65c8ad46bbd8
White Rose Education grant WRE Infinity School a licence to use this content only, subject to our standard terms and conditions.
© White Rose Education Ltd. 2026

3 Use <, > or = to complete the statements.

11 ÷ 1	=	11 × 1
9 × 0	<	12 ÷ 1
9 ÷ 9	=	12 ÷ 12

4 Complete the number sentences.

12 × 12 = **144**

3 × 12 = 36

12 × 4 = **48**

12 × **8** = 96

5 Circle the multiples of 12

132 **42**

60 **120**

36 **144**

Quiz ID: 49d701dd - 6c4b - 4f42 - 9227 - 65c8ad46bbd8

White Rose Education grant WRE Infinity School a licence to use this content only, subject to our standard terms and conditions.

© White Rose Education Ltd. 2026

6 Complete the number sentences.

$48 \div 12 = \boxed{4}$

$\boxed{84} \div 12 = 7$

$144 \div 12 = \boxed{12}$

$\boxed{60} \div 12 = 5$

7 Complete the sentences.



An egg box contains 12 eggs.

There are $\boxed{72}$ eggs in 6 boxes.

There are 132 eggs in $\boxed{11}$ boxes.

8 Use the cards to complete the number sentences.

0	1	2	4

$\square\square\square \times \square = 420$

Any valid multiplication using the available cards.

Quiz ID: 49d701dd - 6c4b - 4f42 - 9227 - 65c8ad46bbd8
White Rose Education grant WRE Infinity School a licence to use this content only, subject to our standard terms and conditions.

© White Rose Education Ltd. 2026

9 Complete the number sentences.

$13 \times 10 =$ **130**

$13 \times 2 =$ **26**

$13 \times 12 =$ **156**

10 Complete the number sentences.

$2 \times 5 \times 5 = 2 \times$ **25** $=$ **50**

$5 \times 1 \times 3 = 5 \times$ **3** $=$ **15**

$5 \times 4 \times 4 = 20 \times$ **4** $=$ **80**

11 Complete the multiplications.

$5 \times 8 \times 5 =$ **200**

$2 \times 6 \times 3 =$ **36**

$5 \times 6 \times 3 =$ **90**

Quiz ID: 49d701dd - 6c4b - 4f42 - 9227 - 65c8ad46bbd8
White Rose Education grant WRE Infinity School a licence to use this content only, subject to our standard terms and conditions.

© White Rose Education Ltd. 2026

12 Use the cards to complete the multiplication.

1	2	3	5	7	9

$\square \times \square \times \square = 90$

Any valid multiplication using the available cards.

Quiz ID: 49d701dd - 6c4b - 4f42 - 9227 - 65c8ad46bbd8
White Rose Education grant WRE Infinity School a licence to use this content only, subject to our standard terms and conditions.

© White Rose Education Ltd. 2026