Name: _____ Date: _____

1 Complete the number track.

33	30							9	

2 Shade in the multiples of 3

31	**32**	**33**	**34**	**35**	**36**	**37**	**38**	**39**	**40**
41	**42**	**43**	**44**	**45**	**46**	**47**	**48**	**49**	**50**
51	**52**	**53**	**54**	**55**	**56**	**57**	**58**	**59**	**60**
61	**62**	**63**	**64**	**65**	**66**	**67**	**68**	**69**	**70**
71	**72**	**73**	**74**	**75**	**76**	**77**	**78**	**79**	**80**

Quiz ID: 558dd5fa - 0838 - 4a69 - 9750 - 82ead7c7d11e
White Rose Education grant WRE Infinity School a licence to use this content only, subject to our standard terms and conditions.
© White Rose Education Ltd. 2026

3 Circle the multiples of 3

18	**16**
72	**745**
854	**636**
3,935	**3,740**

4 Complete the sentences.



There are ☐ vases.

Each vase has ☐ flowers.

There are ☐ flowers in total.

Quiz ID: 558dd5fa - 0838 - 4a69 - 9750 - 82ead7c7d11e
White Rose Education grant WRE Infinity School a licence to use this content only, subject to our standard terms and conditions.

© White Rose Education Ltd. 2026

5 Divide 24 counters into groups of 6 counters.



How many groups of 6 are in the array? ☐

24 ÷ 6 = ☐

6 Write two multiplication and two division facts shown by the array.



☐ × ☐ = ☐

☐ × ☐ = ☐

☐ ÷ ☐ = ☐

☐ ÷ ☐ = ☐

7 Complete the number track.

72	66		54						

Quiz ID: 558dd5fa - 0838 - 4a69 - 9750 - 82ead7c7d11e
White Rose Education grant WRE Infinity School a licence to use this content only, subject to our standard terms and conditions.

© White Rose Education Ltd. 2026

8 Complete the number sentences.

$4 \times 6 = \square$

$\square \times 6 = 12$

$18 \div 6 = \square$

$\square \div 6 = 12$

9 Write two multiplication and two division facts shown by the array.



$\square \times \square = \square$

$\square \times \square = \square$

$\square \div \square = \square$

$\square \div \square = \square$

Quiz ID: 558dd5fa - 0838 - 4a69 - 9750 - 82ead7c7d11e
White Rose Education grant WRE Infinity School a licence to use this content only, subject to our standard terms and conditions.

© White Rose Education Ltd. 2026

10 Circle the multiples of 9

18	**38**
27	**74**
17	**20**
89	**63**

11 Complete the calculations.

90 ÷ 9 = ☐

☐ ÷ 9 = 8

27 ÷ 9 = ☐

☐ ÷ 9 = 9

Quiz ID: 558dd5fa - 0838 - 4a69 - 9750 - 82ead7c7d11e

White Rose Education grant WRE Infinity School a licence to use this content only, subject to our standard terms and conditions.

© White Rose Education Ltd. 2026

12 Complete the calculations.

$6 \times 9 = \square$

$\square \times 9 = 63$

$9 \times 2 = \square$

$9 \times \square = 90$

Quiz ID: 558dd5fa - 0838 - 4a69 - 9750 - 82ead7c7d11e

White Rose Education grant WRE Infinity School a licence to use this content only, subject to our standard terms and conditions.

© White Rose Education Ltd. 2026